Dividing with a Numberline

Name:

Use the numberline to solve each problem.

1) 15÷5=

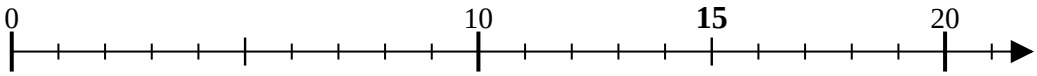

2) 8÷4=

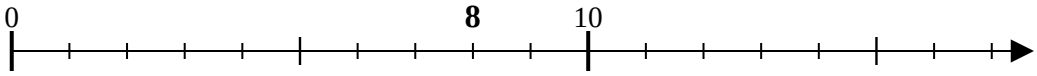

3) 18÷9=

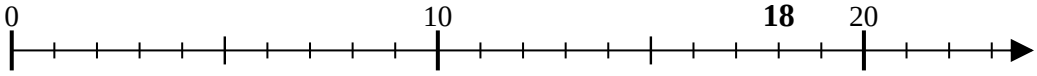

4) 24÷8=

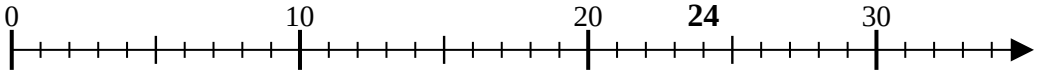

5) 9÷3=

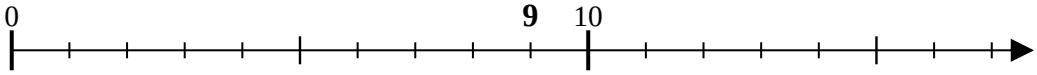

6) 24÷6=

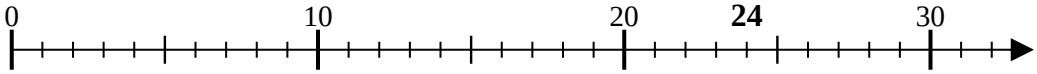

7) 10÷2=

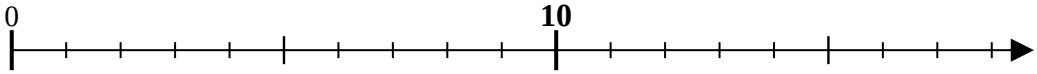

8) 12÷3=

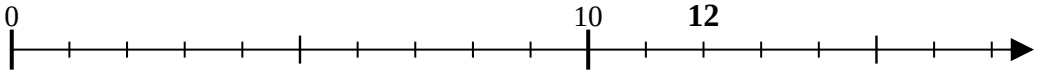

9) 45÷9=

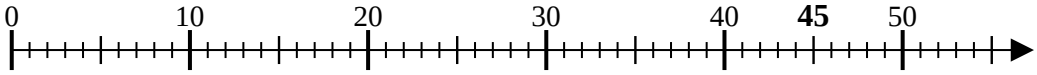

10) 35÷7=

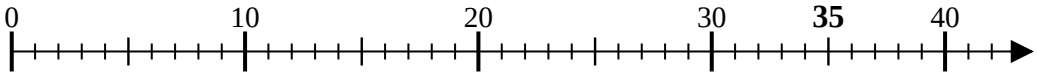

11) 15÷3=

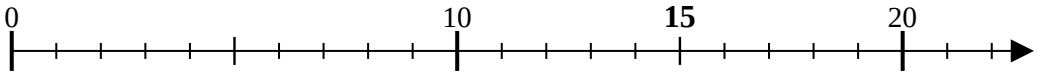

Answers

1. _____
2. _____
3. _____
4. _____
5. _____
6. _____
7. _____
8. _____
9. _____
10. _____
11. _____

1-10	91	82	73	64	55	45	36	27	18	9
11	0									

Dividing with a Numberline

Name: **Answer Key**

Use the numberline to solve each problem.

1) 15÷5=

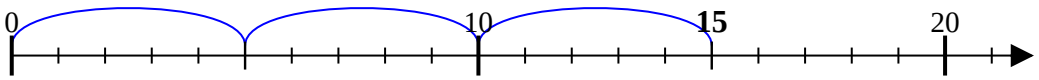

2) 8÷4=

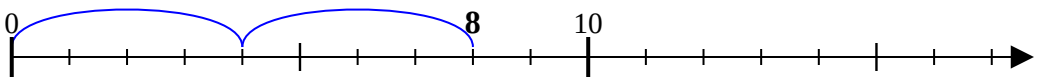

3) 18÷9=

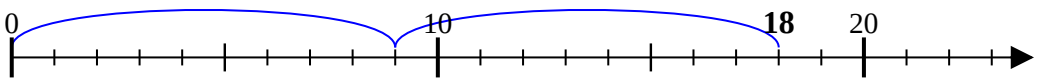

4) 24÷8=

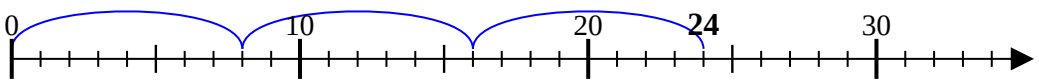

5) 9÷3=

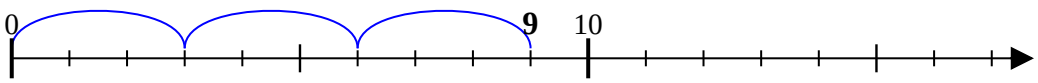

6) 24÷6=

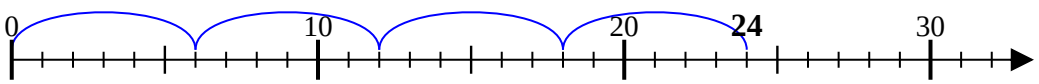

7) 10÷2=

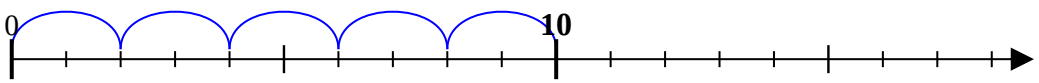

8) 12÷3=

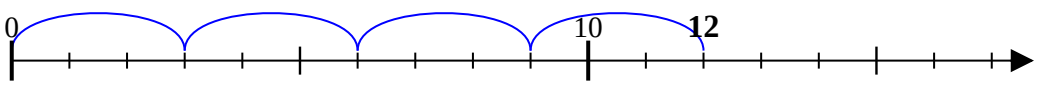

9) 45÷9=

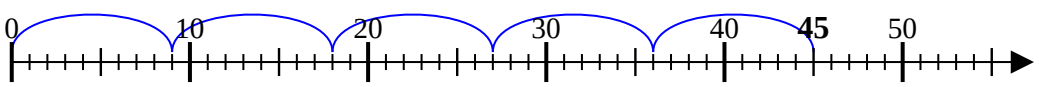

10) 35÷7=

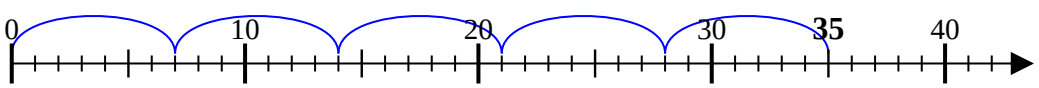

11) 15÷3=

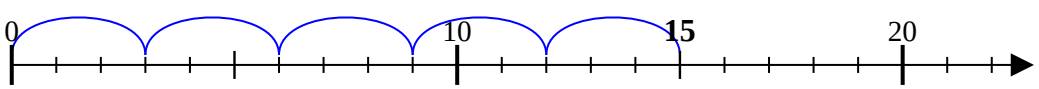

Answers

1. 3
2. 2
3. 2
4. 3
5. 3
6. 4
7. 5
8. 4
9. 5
10. 5
11. 5